Домашнее задание по теме «Измерение физических величин»

1) Определите цену деления приборов, изображенных на рисунках 1-8.
2) Запишите показания приборов с учетом погрешности.



1



2

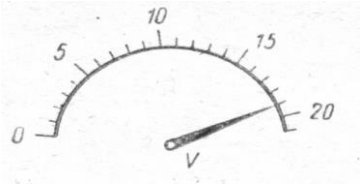

3

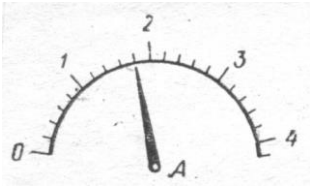

4

5



6



7



8